A tenth is ten hundredths.



Shade, compare, and explain the same whole.

1. Shade one value on each grid. Each whole has 100 equal squares.

0.2



0.18



Write each value in hundredths: _____ / 100 _____ / 100

2. Write <, >, or =. Use the grids or sketch a model to show why.

0.2 _____ **0.18** **0.06** _____ **0.6**

0.72 _____ **0.7** **0.8** _____ **0.80**

3. Explain it to someone at home.

How can two decimal numbers with different digits show the same amount?