Estimate first.



Does the Answer Make Sense? | 3.OA.8

Four trays hold six cookies each. Emmy takes three cookies.
Before calculating, mark about how many will remain.



Build two steps. Draw your model and circle what was taken.



4 ___ 6 then ___ 3 = _____

My estimate was _____. The exact result is _____.
They differ by _____. Does the story fit my model?

Check Emmy's claim

Share ALL 32 cookies equally among four kids, with NONE left.
Emmy says, "Seven cookies each uses every cookie."
Show why her claim does or does not fit. Repair the share.



Each share: _____ Used altogether: _____ Left: _____

Grown-up check: 4 x 6 - 3 = 21. Four shares of 7 use 28; four shares of 8 use all 32.