Check it. Show why.

A claim can be changed when the model gives evidence.



Emmy: I think 5/8 is more than 7/8.

Shade and align equal wholes. Choose <, =, or >.

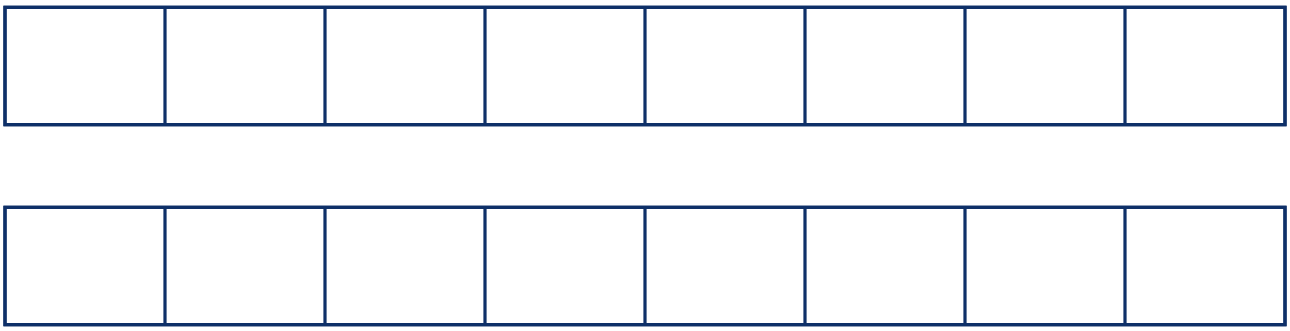

5/8 _____ 7/8

My evidence:

_____

Now compare 1/3 and 1/6 using equal wholes.



1/3 _____ 1/6. Show or explain why.